New York State Testing Program

Mathematics Test

Grade 4

2009 Scoring Guide Part 1

36 Linda drew the shapes shown below.

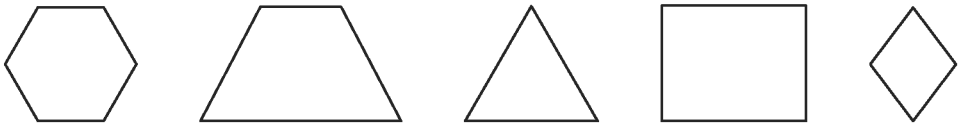

Part A

Draw a large X on the shapes above that are quadrilaterals.

Part B

Next, Linda drew a pentagon. How many sides does a pentagon have?

Answer _____ sides

QUESTION 36

STRAND 3: GEOMETRY

Complete and Correct Response:

- 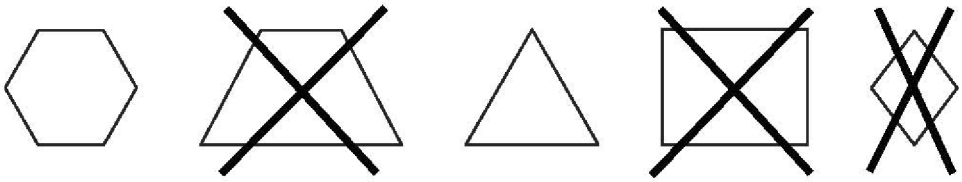

  OR other valid response

AND

- 5 (sides)

Score Points:

Apply 2-point holistic rubric.

NOTE: For scoring instructions for the Braille version of this question, see *Scoring the Braille Edition*.

36 Linda drew the shapes shown below.

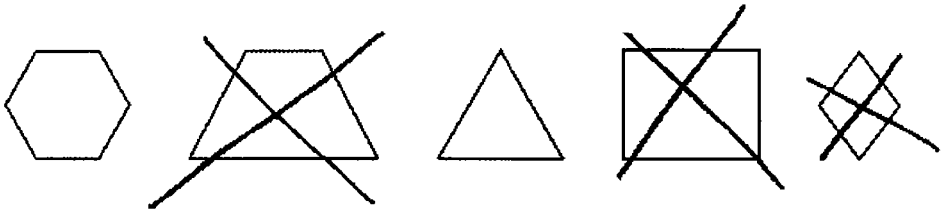

Part A

Draw a large X on the shapes above that are quadrilaterals.

Part B

Next, Linda drew a pentagon. How many sides does a pentagon have?

Answer 5 sides

This response is complete and correct.

Score Point 2

36 Linda drew the shapes shown below.

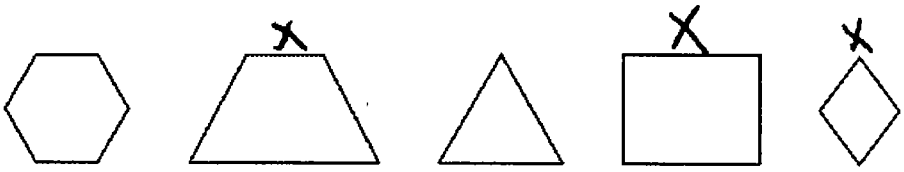

Part A

Draw a large X on the shapes above that are quadrilaterals.

Part B

Next, Linda drew a pentagon. How many sides does a pentagon have?

Answer 5 sides

This response is complete and correct.

Score Point 2

36 Linda drew the shapes shown below.

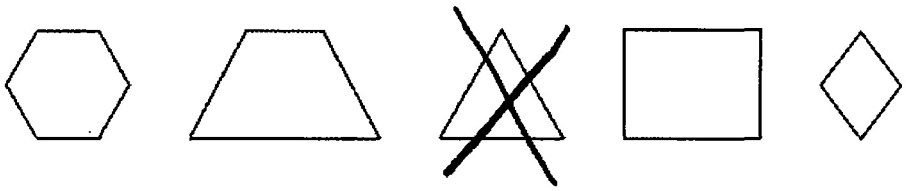

Part A

Draw a large X on the shapes above that are quadrilaterals.

Part B

Next, Linda drew a pentagon. How many sides does a pentagon have?

Answer 5 sides

This response is only partially correct. Part A is incorrect; however, Part B is correct.

Score Point 1

36 Linda drew the shapes shown below.

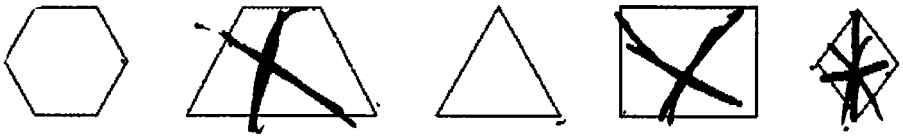

Part A

Draw a large X on the shapes above that are quadrilaterals.

Part B

Next, Linda drew a pentagon. How many sides does a pentagon have?

Answer 8 sides

This response is only partially correct. Part A is correct; however, Part B is incorrect.

Score Point 1

36 Linda drew the shapes shown below.

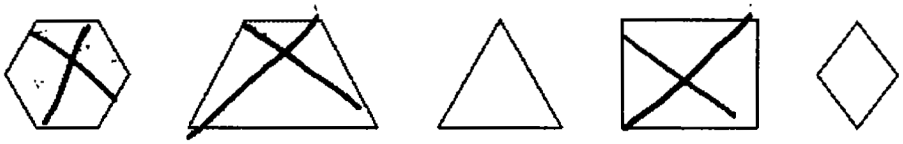

Part A

Draw a large X on the shapes above that are quadrilaterals.

Part B

Next, Linda drew a pentagon. How many sides does a pentagon have?

Answer 6 sides

This response is incorrect.

Score Point 0

New York State Testing Program

Mathematics Test

Grade 4

2009 Practice Set

36 Linda drew the shapes shown below.

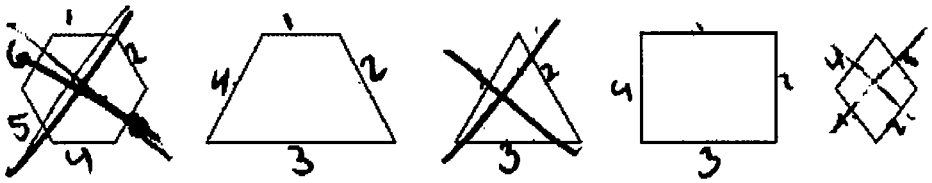

Part A

Draw a large X on the shapes above that are quadrilaterals.

Part B

Next, Linda drew a pentagon. How many sides does a pentagon have?

Answer 4 sides

36 Linda drew the shapes shown below.

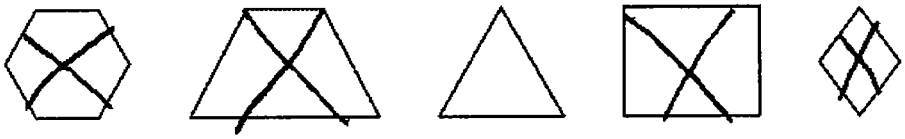

Part A

Draw a large X on the shapes above that are quadrilaterals.

Part B

Next, Linda drew a pentagon. How many sides does a pentagon have?

Answer 5 sides

36 Linda drew the shapes shown below.

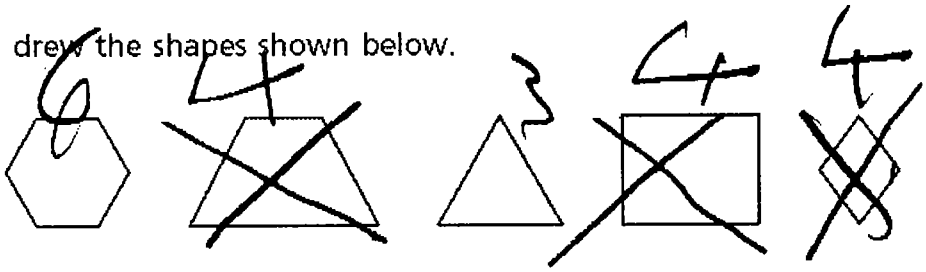

Part A

Draw a large X on the shapes above that are quadrilaterals.

Part B

Next, Linda drew a pentagon. How many sides does a pentagon have?

Answer _____ sides

36 Linda drew the shapes shown below.

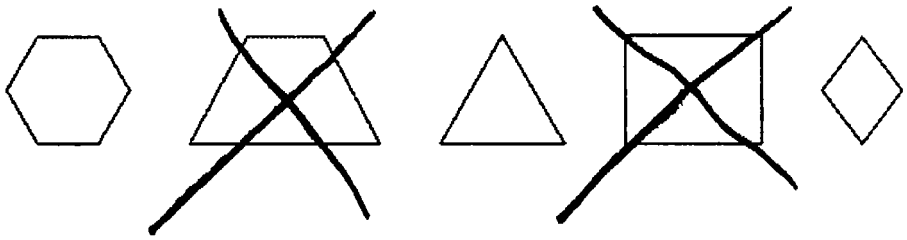

Part A

Draw a large X on the shapes above that are quadrilaterals.

Part B

Next, Linda drew a pentagon. How many sides does a pentagon have?

Answer 6 sides

36 Linda drew the shapes shown below.

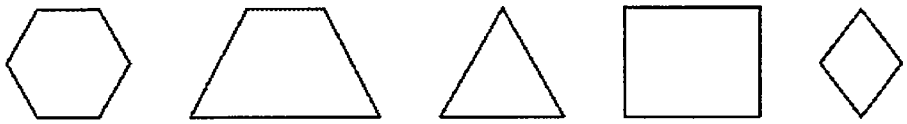

Part A

Draw a large X on the shapes above that are quadrilaterals.

Part B

Next, Linda drew a pentagon. How many sides does a pentagon have?

Answer 5 sides

4TH GRADE MATHEMATICS

Name:_____

PRACTICE SET ANSWER KEY

PS 1	(0-2)	
PS 2	(0-2)	
PS 3	(0-2)	
PS 4	(0-2)	
PS 5	(0-2)	
PS 6	(0-2)	
PS 7	(0-2)	
PS 8	(0-2)	
PS 9	(0-2)	
PS 10	(0-2)	
PS 11	(0-2)	
PS 12	(0-2)	
PS 13	(0-2)	
PS 14	(0-2)	
PS 15	(0-2)	
PS 16	(0-2)	
PS 17	(0-2)	
PS 18	(0-2)	
PS 19	(0-2)	
PS 20	(0-2)	
PS 21	(0-2)	
PS 22	(0-2)	
PS 23	(0-2)	
PS 24	(0-2)	
PS 25	(0-2)	

PS 26	(0-2)	
PS 27	(0-2)	
PS 28	(0-2)	
PS 29	(0-2)	
PS 30	(0-2)	
PS 31	(0-2)	
PS 32	(0-2)	
PS 33	(0-2)	
PS 34	(0-2)	
PS 35	(0-2)	
PS 36	(0-3)	
PS 37	(0-3)	
PS 38	(0-3)	
PS 39	(0-3)	
PS 40	(0-3)	
PS 41	(0-3)	
PS 42	(0-3)	
PS 43	(0-3)	
PS 44	(0-3)	
PS 45	(0-3)	
PS 46	(0-2)	
PS 47	(0-2)	
PS 48	(0-2)	
PS 49	(0-2)	
PS 50	(0-2)	

4TH GRADE MATHEMATICS

Name:_____

PRACTICE SET ANSWER KEY

PS 51	(0-2)	
PS 52	(0-2)	
PS 53	(0-2)	
PS 54	(0-2)	
PS 55	(0-2)	
PS 56	(0-2)	
PS 57	(0-2)	
PS 58	(0-2)	
PS 59	(0-2)	
PS 60	(0-2)	
PS 61	(0-2)	
PS 62	(0-2)	
PS 63	(0-2)	
PS 64	(0-2)	
PS 65	(0-2)	
PS 66	(0-2)	
PS 67	(0-2)	
PS 68	(0-2)	
PS 69	(0-2)	
PS 70	(0-2)	

PS 71	(0-2)	
PS 72	(0-2)	
PS 73	(0-2)	
PS 74	(0-2)	
PS 75	(0-2)	
PS 76	(0-2)	
PS 77	(0-2)	
PS 78	(0-2)	
PS 79	(0-2)	
PS 80	(0-2)	
PS 81	(0-3)	
PS 82	(0-3)	
PS 83	(0-3)	
PS 84	(0-3)	
PS 85	(0-3)	
PS 86	(0-3)	
PS 87	(0-3)	
PS 88	(0-3)	
PS 89	(0-3)	
PS 90	(0-3)	